Comparing numbers (2)

1 Which is the smallest number in each pair?

Tick your answer.

a)

Tens	Ones
4	6

Tens	Ones
5	1

b)

Tens	Ones
7	2

Tens	Ones
7	1

How did you know which number to tick?

2 Circle the greater number in each pair.

a) **37** **81**

b) **90** **9**

c) **16** **72**

3 Write <, > or = to compare the numbers.

a) 19 ◯ 41

b) 51 ◯ 24

c) 79 ◯ 80

d) 100 ◯ 93

4 Use the digit cards.

0	1	2	3	4	5	6

Make a number greater than 25 ☐

Make a number less than 72 ☐

Make a number greater than 59 ☐

Talk about your answers.

5 Ron, Sam and Kim have each made a number.



My number has 7 tens and some ones.

Ron

My number has 8 tens and some ones.



Sam

My number has 6 tens and some ones.



Kim

a) Who has made the smallest number?

_____

b) Who has made the greatest number?

_____

Talk about it with a partner.

© White Rose Maths 2020